TIZEDESTÖRTEK ÉRTELMEZÉSE

Melyik számra gondoltunk?

Keresd meg a 4x5−ös rácson a számot és színezd ki a leírás melletti módon!

Milyen alakzatot kaptál?

7,107	35,192	71,7
5,8977	35,489	26,64
1,676	2,4945	36,5
1,013	37,44	0,956
0,643	63,23	7,3607

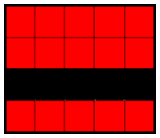
32 egyes + 4 század + 56 tized =

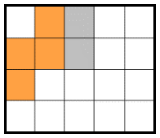
3 tízes + + 25 tized + 4 egyes=

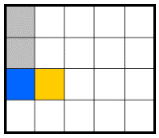
47 tízezred + 73 tized + 56 ezred =

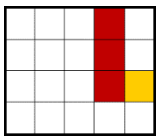
56 század + 83 ezred =

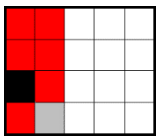
91 század + 46 ezred =

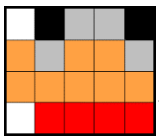
15 tized + 587 ezred + 75 tízezred =

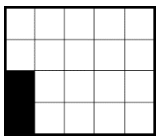
69 egyes + 27 tized =

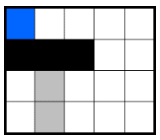
24 egyes +24 tized +24 század =

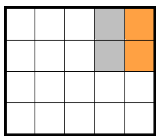
16 század + 16 tized + 16 ezred =

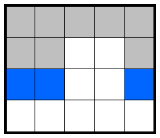
5 tízes + 23 század + 12 egyes =

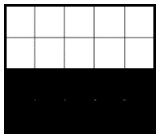
28 század + 9 tized + 34 egyes + 12 ezred =

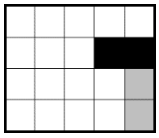
897 tizezred + 458 ezred + 15 század + 52 tized =

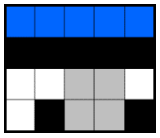
8 tized + 34 egyes + 67 század + 19 ezred =

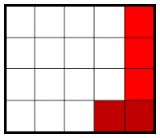
89 század + 123 ezred =

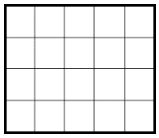
Minden más szám.

WWW.SZENTESKEP.HU

Megoldás: